S3-63: Dividing by Skip Counting *(continued)*

3. You can solve the division problem **12 ÷ 3 = ?** by skip counting on the number line.

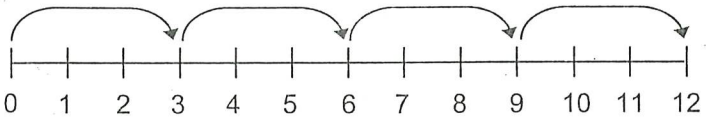

The number line shows that it takes 4 skips of size 3 to get 12:

3 + 3 + 3 + 3 = 12, so ... **12 ÷ 3 = 4**

Use the number lines provided to find the answer to the following division questions.

a)

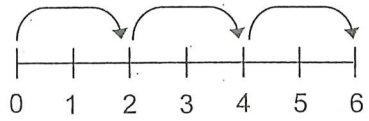

6 ÷ 2 = 3

b)

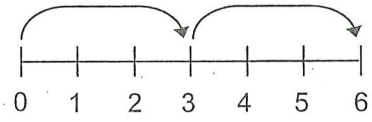

6 ÷ 3 = ____

Use the number line to find the answer to the division statement.

HINT: Be sure to draw arrows to show your skip counting.

a)

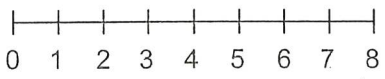

8 ÷ 4 = ____

b)

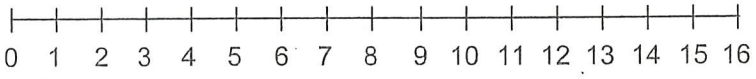

16 ÷ 4 = ____

c)

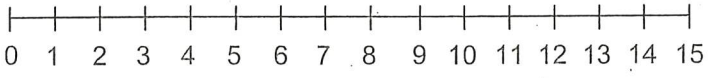

15 ÷ 5 = ____

d)

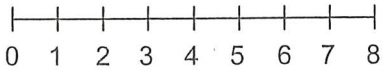

8 ÷ 2 = ____

What division statement does the picture represent?

a)

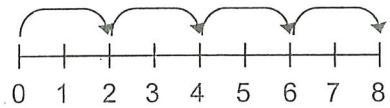

_____

b)

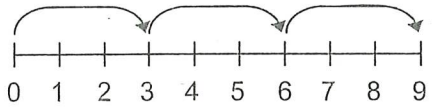

_____

c)

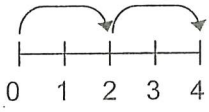

_____

d)

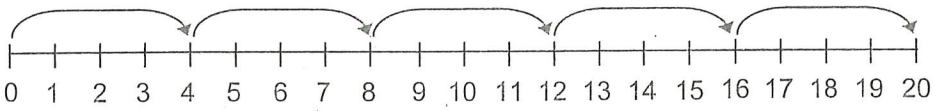

_____